PRIMARY EXAMS MID TERM 1 2017

SOCIAL STUDIES/CRE STANDARD FIVE

SCHOOLS NET KENYA
Osiligi House, Opposite KCB, Ground Floor
Off Magadi Road, Ongata Rongai | Tel: 0711 88 22 27
E-mail:infosnkenya@gmail.com | Website: www.schoolsnetkenya.com

STANDARD FIVE

TERM 1 - 2017

SOCIAL STUDIES / C.R.E.

5

TIME: 2HRS 15 MINS

ICHOGO AREA

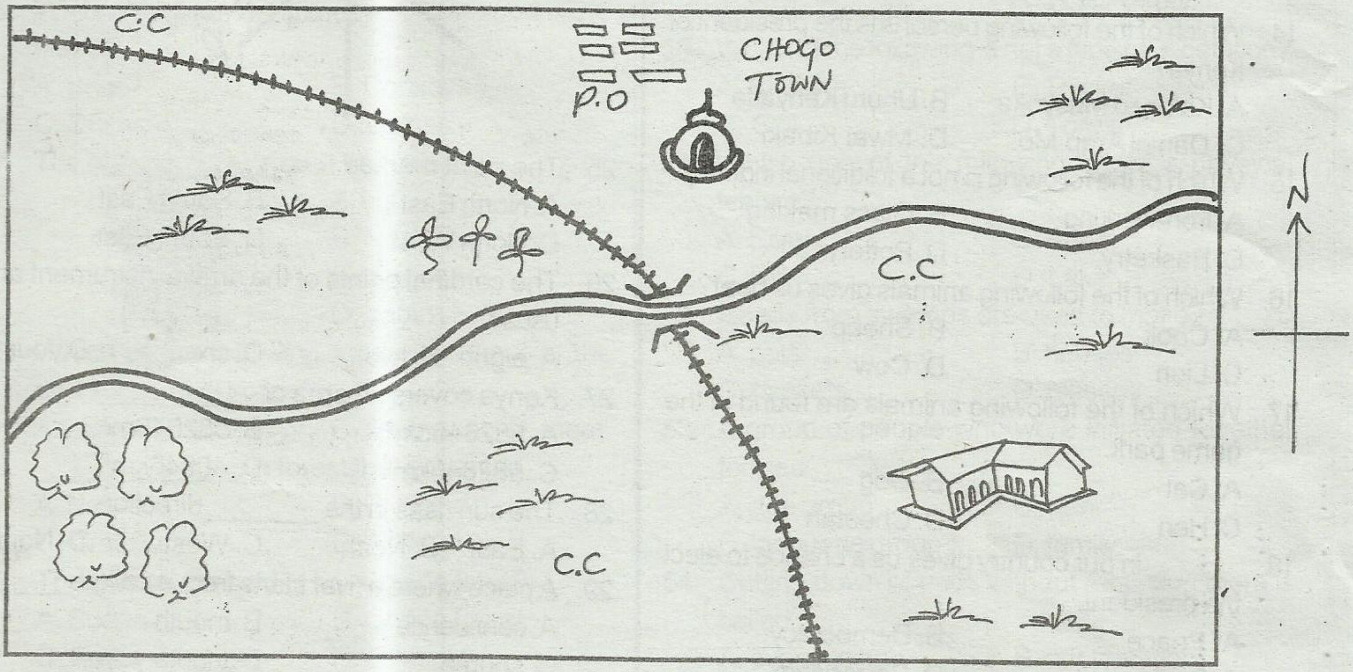

KEY

Permanent building

Post Office – P.O

Forest

Tarmac road

Railway

School

C.C Chief's Camp

Tea

Study the map of Ichogo Area to answer questions 1-7

1. The climate of Ichogo area is _____
   A. hot and dry B. cold and dry
   C. cold and wet D. hot and wet
2. _____ is the main economic activity of Ichogo town.
   A. Trading B. Fishing
   C. Mining D. Racing
3. How many chief camps are found in Ichogo town
   A. one B. two C. three D. four
4. What is the direction of the school from the town?
   A. North B. South C. East D. West
5. Ichogo area is found in the _____
   A. Highlands B. Lake basin
   C. Lowlands D. None
6. The head of Ichogo area is likely to be a _____
   A. Chief B. District commissioner
7. Which religion do people of Ichogo area belong to?
   A. Christians BIslam
   C. Church D. Mosque
8. The walls of the rift valley are called _____?
   A. hills B. escarpments
   C. ridges D. plains
9. _____ is a family where there is one parent and children.
   A. Single parent B. Nuclear family
   C. Extended D. Mahogany
10. Which of the following people were not involved in organizing a marriage ceremony?
    A. Relatives B. Elders
    C. Parents D. Children
11. Which one is a traditional form of transport?
    A. Lorries B. Canoes
    C. Buses D. Ship

12. _____ is the method of sending messages.
A. Transport B. Shelter
C. Competition D. Communication

13. Which is not a problem facing trade?
A. Labour
B. Fires
C. Lack of enough money
D. Poor transport

14. Which of the following persons is the president of Kenya?
A. Kalonzo Musyoka B. Uhuru Kenyatta
C. Daniel Arap Moi D. Mwai Kibaki

15. Which of the following is not a traditional industry?
A. Iron-working B. Glass making
C. Basketry D. Pottery

16. Which of the following animals gives us beef?
A. Cook B. Sheep
C. Lion D. Cow

17. Which of the following animals are found in the game park.
A. Cat B. Dog
C. Hen D. Cheetah

18. _____ in our country gives us a chance to elect the president.
A. Peace B. Democracy
C. Parliament D. Citizenship

19. Conflicts occur when people _____
A. fail to understand each other
B. live together
C. are from different community
D. work together

20. We must obey and respect our parents because they ___
A. will beat us B. take care of us
C. educate us D. are old

21. Which of the following is a family need which they can do without?
A. car B. food
C. shelter D. clothes

22. Building stones are mined at a place called ____
A. Swamp B. Quarry
C. Valley D. River

23. Cattle kept for meat are called_____
A. broilers B. beef cattle
C. pork D. dairies

24. The head of a location is called _____
A. Sub-chief B. D.C.
C. D.O D. Chief

Use instrument below to answer questions 25 and 26

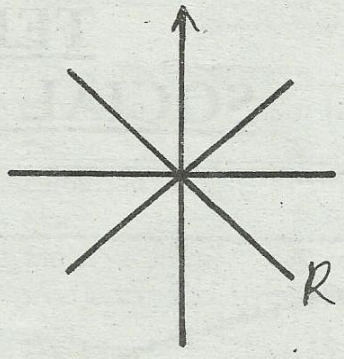

25. The point marked **R** is _____
A. North East B. South East
C. North West D. South East

26. The cardinal points of the drawn instrument are usually
A. eight B. two C. six D. four

27. Kenya covers an area of _____
A. 582646cm² B. 582646m²
C. 582646km² D. 40646km²

28. The sun rises in the _____ direction
A. East B. North C. West D. North

29. A place where a river starts from is called _____
A. confluence B. mouth
C. source D. tributary

30. Which work was done by boys in the past?
A. Cooking
B. Washing utensils
C. Making pots and bowls
D. Looking after cattle

31. A river that does not flow throughout the year is called _____
A. seasonal river B. permanent river
C. short river D. swampy river

Use the diagram below to answer questions 32 to 33



32. The above diagram shows the formation of _____ rainfall.
A. convectional B. mountain
C. relief D. lake

33. Name the side marked **B.**

C. Leeward D. slope

34. Which one of the following is an element of weather?
A. Sunshine B. Charcoal
C. Soil D. Trees

35. Which of these soils is the best for modelling pots?
A. Loam B. Sandy
C. Stoney D. Clay

36. Which of the following means of transport is the oldest?
A. Ship B. Donkeys
C. Buses D. Lorries

37. The drawn structure below shows a _____

A. hut
B. house
C. granary
D. cabin

38. Which of the following foods was kept in the structure drawn above?
A. milk B. grains C. flowers D. meat

39. _____ is a forest that is planted.
A. Natural B. Riverline
C. Grassland D. Artificial

40. The Bantus are said to have come from?
A. Sudan B. Congo forest
C. Egypt D. Ethiopia

41. Who among the following is the head of a county?
A. Senator B. Governor
C. MP D. MCA

42. In our country we elect the president after every _____ years.
A. one B. five C. ten D. six

43. Pyrethrum is processed to get _____
A. insecticide B. tea
C. soap D. kerosene

44. The people's way of life is known as _____?
A. moral values B. rits of passage
C. settlement D. culture

45. The instrument drawn below measures?

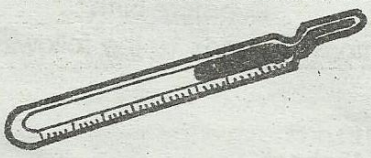

A. food
B. rainfall
C. temperature
D. time

46. The instrument above is called _____
A. windvane B. thermometer
C. barometer D. clock

47. A forest where trees grow on their own is called____?
C. man-made D. low forest

48. Things that are bought from other countries into Kenya are called _____?
A. imports B. exports
C. trade goods D. food crops

49. Who among the following people was Kenya's first president?
A. Daniel Moi B. Jomo Kenyatta
C. Raila Odinga D. Mwai Kibaki

50. Which of the following is not a type of vegetation?
A. Riverine B. Thicket
C. Soil D. Forest

51. Which one of the following is not a physical feature?
A. River B. Road
C. Hill D. Lake

52. Reeds from swamps are used to make _____
A. pots B. houses
C. baskets D. glasses

53. A group of people who were initiated together formed _____
A. age group B. clan
C. language group D. family

54. Cutting down of trees without replacing them is called _____
A. over cutting B. afforestation
D. deforestation D. forestry

55. The flag of Kenya has many colours. Which colour shows Kenyan people?
A. White B. Green C. Black D. Red

56. Which of the following is got from sunflower?
A. Juice B. Kerosene
C. Reeds D. Cooking oil

57. Which people call God Cheptalel?
A. Kipsigis B. Abaluhya
C. Turkana D. Luo

58. The traditional house below above belongs to?

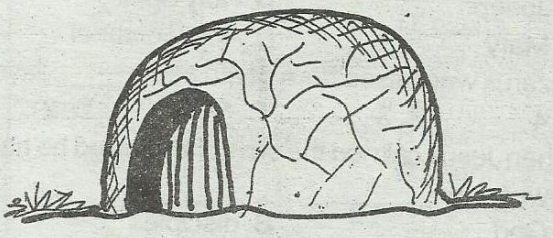

A. Nandi B. Samburu
C. Njemps D. Maasai

59. In the past many houses could be constructed forming a
A. shrine B. shelter

60. Which of the following towns in Kenya is the capital city?
A. Mombasa B. Nairobi
C. Nakuru D. Machakos

C.R.E.

61. God created man in His own _____
A. size B. image
C. wisdom D. sins
62. Who was asked to sacrifice his son Isaac?
A. Moses B. Adam
C. Cain D. Abraham
63. God saved Noah from the _____
A five B. drought
C. floods D. slavery
64. Moses was sent by God to lead the Israelites from_____
A. Israel B. Canaan
C. Egypt D. Nazareth
65. God gave Moses _____ commandments.
A. 10 B. 15 C. 12 D. 5
66. The fifth commandment requests us to _____ our parents.
A. obey B. abuse
C. hate D. fight
67. Who said **"your people are my people"**?
A. Naomi B. Orpha
C. Sarah D. Ruth
68. David and Jonathan were _____ friends.
A. royal B. false
C. loyal D. selfish
69. Whose name was changed to Israel?
A. Jacob B. Abraham
C. Isaac D. Esau
70. Joseph was sold by his _____
A. father B. mother
C. brothers D. sisters
71. Jesus was conceived by the power of _____
A. Joseph B. Holy Spirit
C. Mary D. Angel Gabriel
72. Lazarus was raised from death after _____ days.
A. 4 B. 3 C. 6 D. 2
73. When Jesus calmed the storm he showed he had power over _____
A. God B. disciples
C. man D. nature
74. Jesus changed water into _____ at the wedding.
A. milk B. blood
C. bread D. wine
75. Who helped Jesus carry the cross?
C. Soldiers D. Simon Cyrene
76. Jesus was crucified at a place called _____
A. Golgotha B. Gethsemane
C. Sinai D. Olives
77. Jesus earthly father was a _____
A. fisherman B. teacher
C. pastor D. carpenter
78. Lazarus had two sisters namely _____
A. Martha, Mary B. Esther, Martha
C. Mary, Veronica D. Veronica, Martha
79. A good leader should have the following qualities except _____
A. kindness B. love
C. patience D. jealousy
80. Christians pray in a _____
A. mosque B. cave
C. ocean D. church
81. Which of the following cannot bring peace?
A. Love B. Sharing
C. Tribalism D. Education
82. Agikuyu called their God _____
A. Enkai B. Asis C. Nyasaye D. Ngai
83. God _____ forgives us our sins.
A. always B. rarely
C. often D. sometimes
84. John the Baptist baptized Jesus in river _____
A. Nile B. Tana
C. Jordan D. Cana
85. Lawful authority comes from _____
A. MPS B. president
C. God D. man
86. When is the resurrection of Jesus remembered?
A. Easter Sunday B. Good Friday
C. Christmas D. Pentecost
87. Which book is not in the New Testament?
A. Job B. Mark
C. Acts D. Luke
88. When does God come to know us?
A. after birth B. during birth
C. never D. before birth
89. Bad sexual relationship leads to the following except?
A. pregnancy
B. dropping out of school
C. passing exams
D. disease infections
90. We should always encourage our friends to have?
A. respect B. selfishness
C. pride D. anger