STANDARD 1 EXAM MID TERM 2, 2016
MATHEMATICS

Write the missing numbers

1. 1, 2, 3, ____, 5, ____, 7, 8
2. 11, ___, ___, 14, ____, 16, ___, 18
3. 10, 20, ____, 40, 50, ____
4. 56, ____, ____, 59, 60

Add

5. 3 + 4 + 2 =
6. 6 + 5 + 6 =
7. 0 + 2 + 7 =
8. 26 + 13 =
9. 52 + 12 =
10. 90 + 60 =
11. 6 + 3 = ____
12. 5 + 5 = ____
13. 15 + 10 = ____
14. 33 + 35 = ____

Write in words

15. 9 _____
16. 0 _____
17. 2 _____
18. 6 _____
19. 10 _____

Find the missing numbers

20. ☐ + 2 = 12
21. 8 + ☐ = 8
22. ☐ + 3 = 10
23. ☐ - 2 = 5
24. 6 - ☐ = 1
25. 50 - 20 = ☐
26. ☐ + 3 = 7

Compiled by Schools Net Kenya, Std 1 Exam Mid-Term 2, 2016
Available online at www.schoolsnetkenya.com | E-mail: infosnkenya@gmail.com | Mobile: 0711882227

27. Take away four from ten _____

28. Which is the second month of the year _____
(March, December, February)

29. **Arrange in order from the smallest to largest**
28, 40, 18, 34, 43,

_____

Name the shapes

30 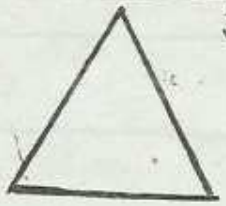

31.

_____ _____

32 

_____

33. 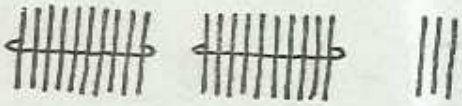

_____ tens _____ ones

34. 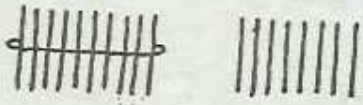

_____ tens _____ ones

35. 

_____ tens _____ ones

36. Which line is straight?

37. A dog has _____ legs.

38. I have _____ fingers.

39. There are _____ days in one week.

40. 5 apples and 4 apples = _____ apples.

41. 80 - 30 = _____

42. Which is smaller .
Cup Spoon

Circle the correct number

43. eight = **(18, 10, 8)**

44. twelve **(20, 12, 2)**

45. four = **(4, 14, 40)**

46. Thirteen = **(30, 3, 13)**

Count and write

47. 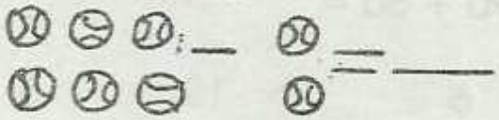

48. 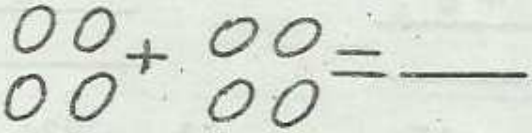

49. 23 + 4 =

50. Three teaches have _____ eyes.

Compiled by Schools Net Kenya, Std 1 Exam Mid-Term 2, 2016
Available online at www.schoolsnetkenya.com | E-mail: infosnkenya@gmail.com | Mobile: 0711882227